PATTERNS ***ANSWERS***

1. red, green, blue, yellow, red, red, green, blue, yellow, red, RED ?

2. 2 , 2 , 5 , 5 , 8 , 8 , 11 , 11 , 14 , 14 , 17 , 17
   ? ? ?

3. 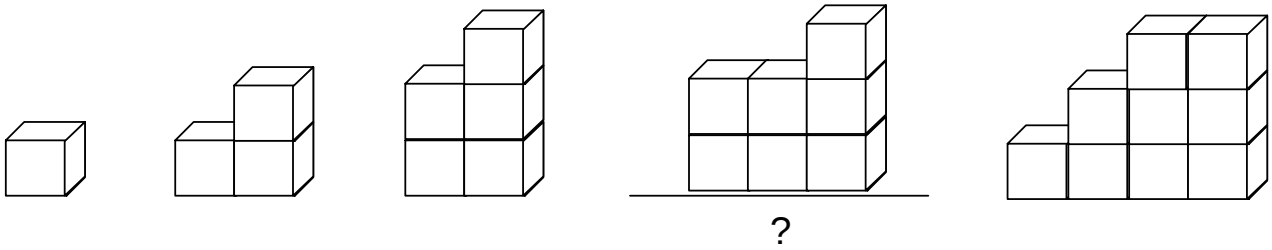
   ?

4. 15 , 20 , 30 , 35 , 45 , 50 , 60 , 65 , 75 , 80 , 90
   ? ?

5. 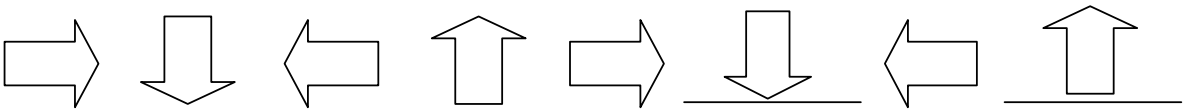
   ? ?

6. 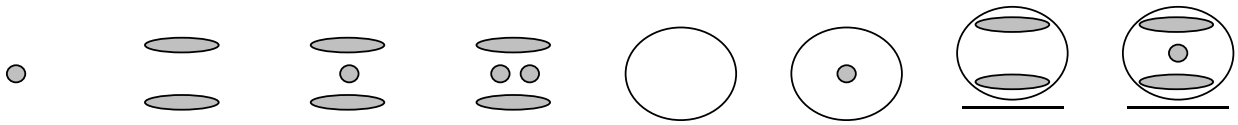
   ? ?

7. Queen walks .5 miles on Monday morning and runs 1 mile in the evening. On Tuesday she walks 1 mile after breakfast and runs 1.25 miles at night. She also walks and runs 1.5 miles on Wednesday. If this pattern continues how much will she walk and run on Thursday, Friday, Saturday, and Sunday?

	M	T	W	TH	FR	SA	SUN
WALK	.5	1	1.5	2	2.5	3	3.5
RUN	1	1.25	1.5	1.75	2	2.25	2.5